Unit fractions

1 Complete the sentences for each shape.

a)

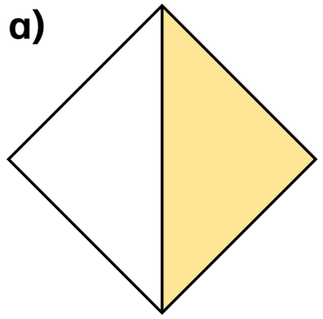

There are ☐ equal parts.

There is ☐ part shaded.

☐ is shaded.

b)

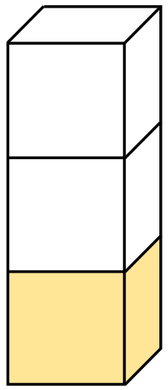

There are ☐ equal parts.

There is ☐ part shaded.

☐ is shaded.

2 There are ☐ equal parts.



There is ☐ part circled.

☐ is circled.

3 Tick the shape that has $\frac{1}{2}$ shaded.

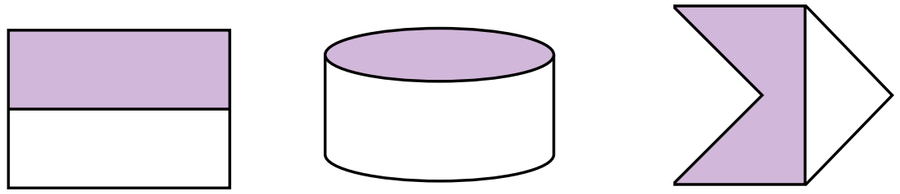

☐ ☐ ☐

4 Tick the shape that has $\frac{1}{3}$ shaded.

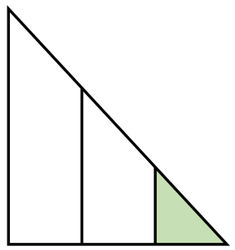

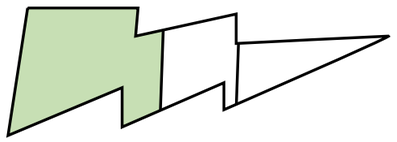

☐ ☐

☐

© White Rose Maths 2019

5 Tick the shapes that have $\frac{1}{4}$ shaded.

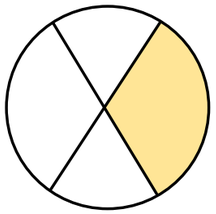

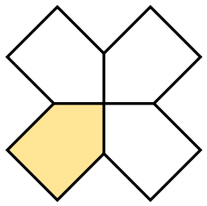

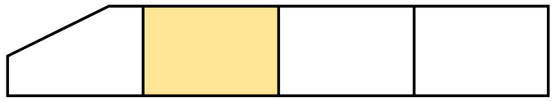

6 What fraction of each shape is shaded?

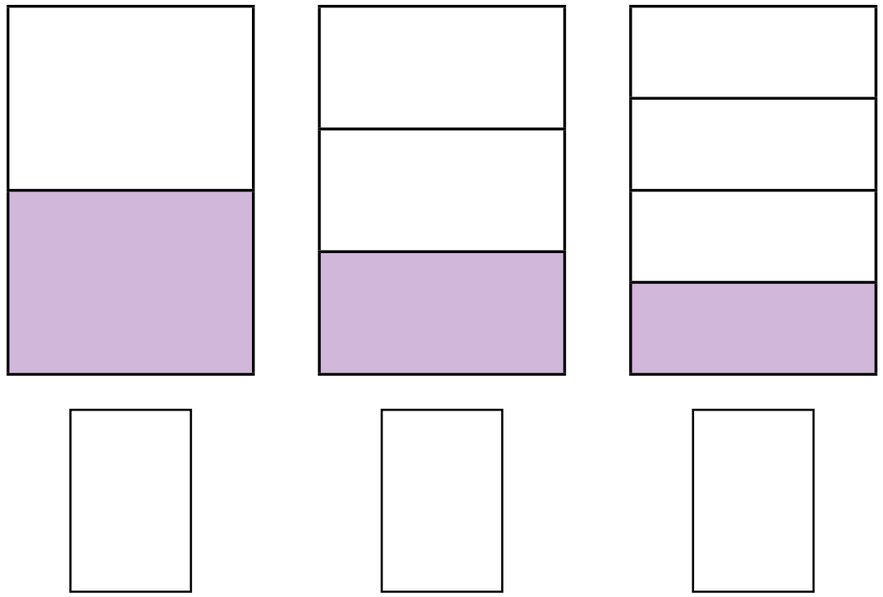

What is the same about the fractions?

What is different about them?

7 Here are some fractions.

$\frac{1}{2}$	$\frac{2}{3}$	$\frac{3}{4}$	$\frac{1}{4}$	$\frac{1}{3}$

Tick all the unit fractions.

Compare answers with a partner.

Can you think of any more unit fractions?

8 Match the objects to the unit fractions.

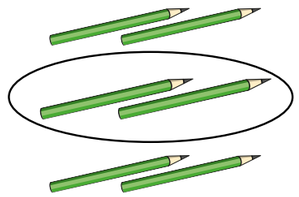



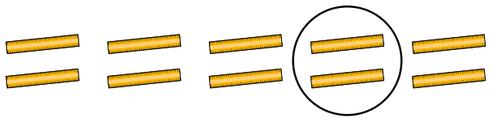

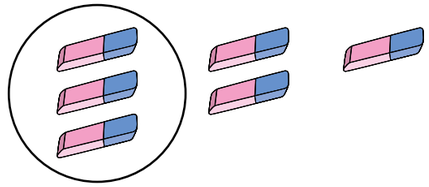

$\frac{1}{2}$
$\frac{1}{3}$
$\frac{1}{4}$
$\frac{1}{5}$

© White Rose Maths 2019